小3 たし算とひき算の筆算 とっくんドリル②-5

なまえ ＿＿＿＿＿＿＿＿

くり下がりを、ていねいに 全12問

ひづけ ＿＿＿＿＿＿＿＿

筆算のマスを使ってとく。くり下がりで書きかえた上の数は、そのくらいの上のマスに書く。答えは下線に書く

1 444 − 187 = ＿＿＿＿

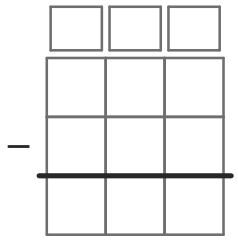

2 202 − 76 = ＿＿＿＿

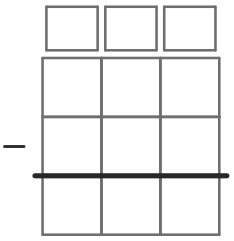

3 223 − 59 = ＿＿＿＿

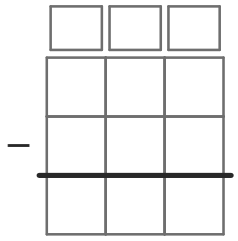

4 505 − 466 = ＿＿＿＿

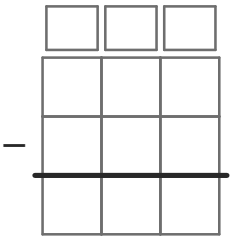

5 9266 − 5370 = ＿＿＿＿

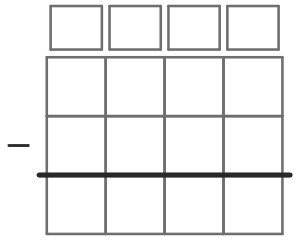

6 2502 − 2229 = ＿＿＿＿

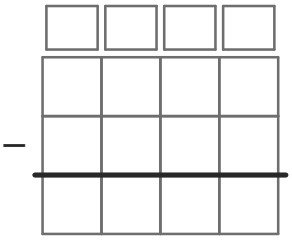

7 852 − 209 = ＿＿＿＿

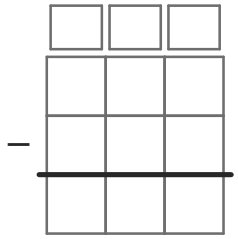

8 802 − 639 = ＿＿＿＿

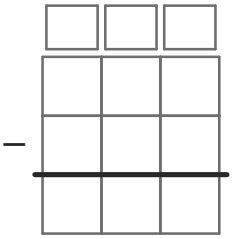

9 875 − 246 = ＿＿＿＿

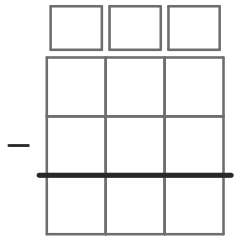

10 9024 − 5764 = ＿＿＿＿

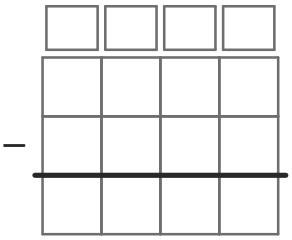

11 353 − 349 = ＿＿＿＿

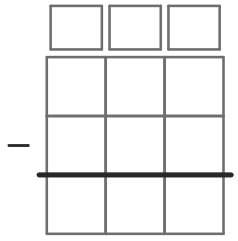

12 5001 − 4721 = ＿＿＿＿

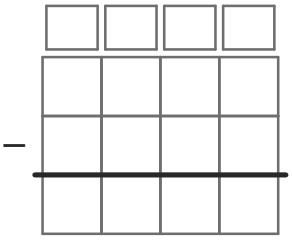

いちごドリル プリント

つづきの無料プリント
「小3のたし算とひき算の…」のプリント一覧がひらきます