小3 たし算とひき算の筆算 とっくんドリル②-4

なまえ ＿＿＿＿＿＿＿＿

くり下がりを、ていねいに 全12問

ひづけ ＿＿＿＿＿＿＿＿

筆算のマスを使ってとく。くり下がりで書きかえた上の数は、そのくらいの上のマスに書く。答えは下線に書く

1 6872 − 6018 = ＿＿＿＿

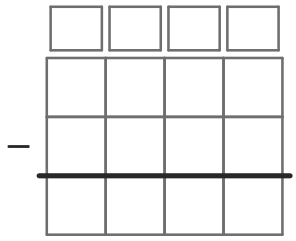

2 8004 − 4855 = ＿＿＿＿

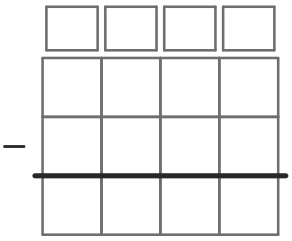

3 1137 − 253 = ＿＿＿＿

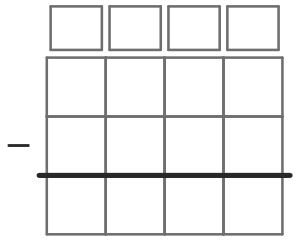

4 605 − 197 = ＿＿＿＿

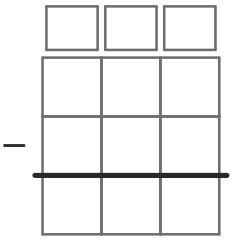

5 6761 − 776 = ＿＿＿＿

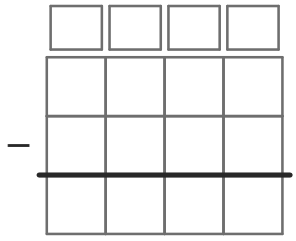

6 5001 − 966 = ＿＿＿＿

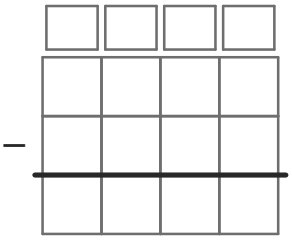

7 4191 − 4077 = ＿＿＿＿

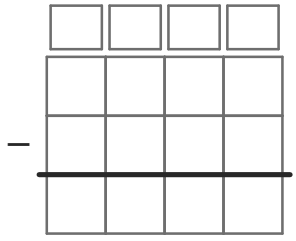

8 7004 − 4250 = ＿＿＿＿

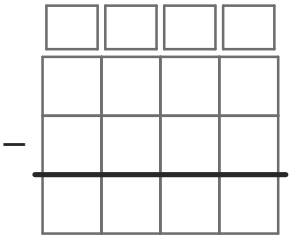

9 247 − 179 = ＿＿＿＿

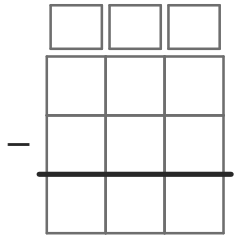

10 5006 − 2598 = ＿＿＿＿

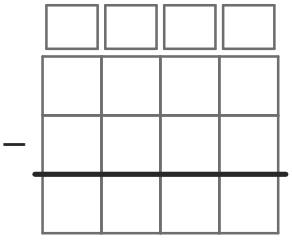

11 7499 − 2841 = ＿＿＿＿

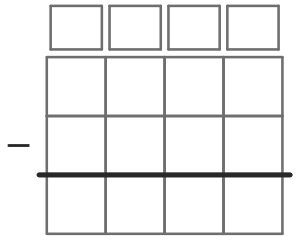

12 904 − 779 = ＿＿＿＿

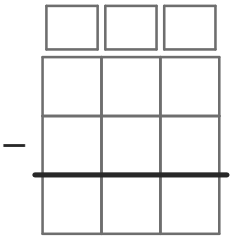

いちごドリル プリント

つづきの無料プリント
「小3のたし算とひき算の…」のプリント一覧がひらきます