小3 たし算とひき算の筆算 とっくんドリル②-3

なまえ ＿＿＿＿＿＿＿＿

くり下がりを、ていねいに 全12問

ひづけ ＿＿＿＿＿＿＿＿

筆算のマスを使ってとく。くり下がりで書きかえた上の数は、そのくらいの上のマスに書く。答えは下線に書く

1 4523 − 524 = ＿＿＿＿

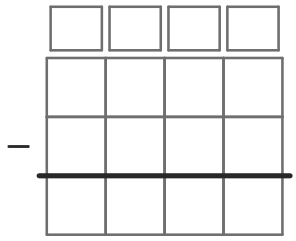

2 2004 − 172 = ＿＿＿＿

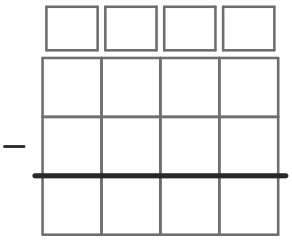

3 611 − 545 = ＿＿＿＿

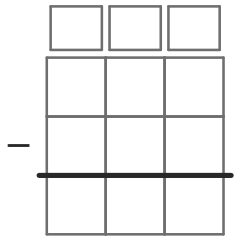

4 401 − 368 = ＿＿＿＿

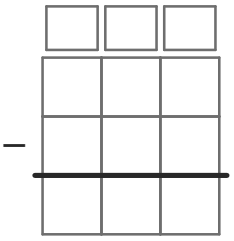

5 9923 − 9032 = ＿＿＿＿

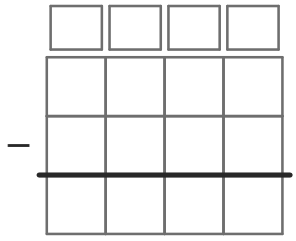

6 804 − 547 = ＿＿＿＿

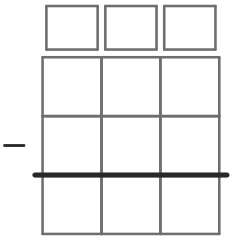

7 431 − 343 = ＿＿＿＿

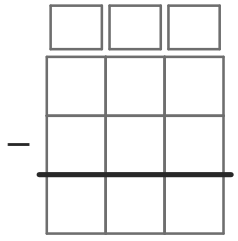

8 702 − 447 = ＿＿＿＿

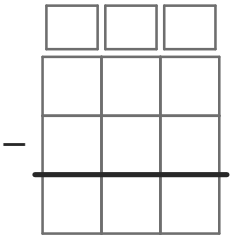

9 748 − 519 = ＿＿＿＿

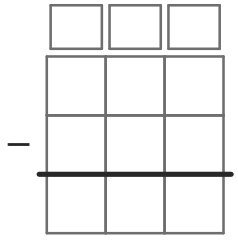

10 2004 − 1735 = ＿＿＿＿

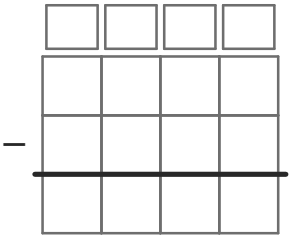

11 174 − 58 = ＿＿＿＿

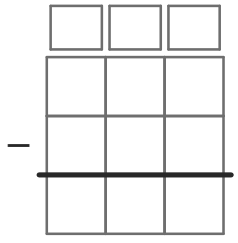

12 5004 − 2861 = ＿＿＿＿

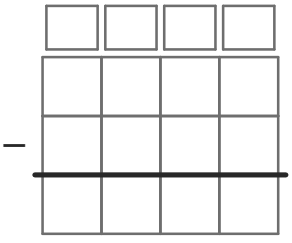

いちごドリル プリント

つづきの無料プリント
「小3のたし算とひき算の…」のプリント一覧がひらきます