小3 たし算とひき算の筆算 とっくんドリル②-2

なまえ ＿＿＿＿＿＿＿＿

くり下がりを、ていねいに 全12問

ひづけ ＿＿＿＿＿＿＿＿

筆算のマスを使ってとく。くり下がりで書きかえた上の数は、そのくらいの上のマスに書く。答えは下線に書く

1 353 − 188 = ＿＿＿＿

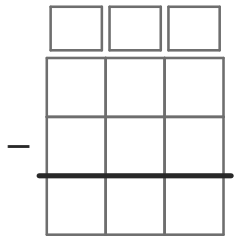

2 4902 − 2016 = ＿＿＿＿

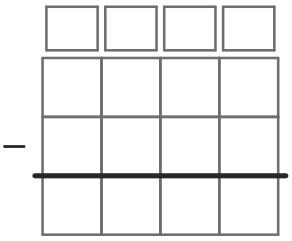

3 683 − 336 = ＿＿＿＿

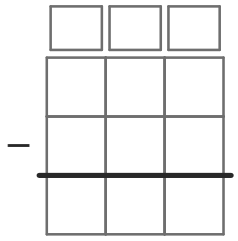

4 7001 − 5165 = ＿＿＿＿

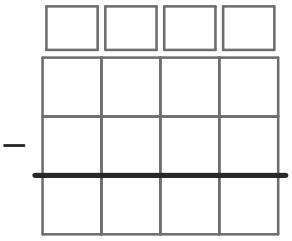

5 6121 − 1424 = ＿＿＿＿

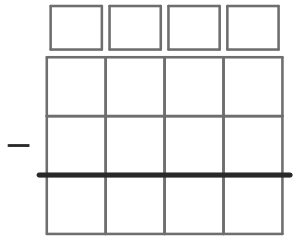

6 7502 − 1085 = ＿＿＿＿

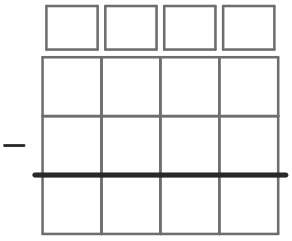

7 3165 − 1216 = ＿＿＿＿

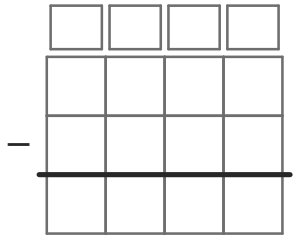

8 4008 − 2031 = ＿＿＿＿

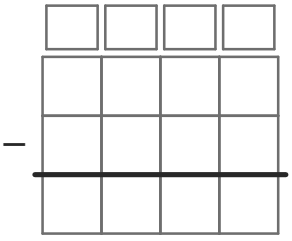

9 8556 − 4091 = ＿＿＿＿

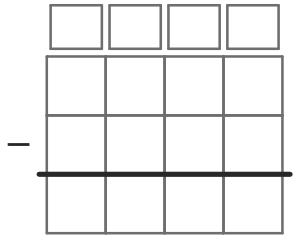

10 4005 − 1382 = ＿＿＿＿

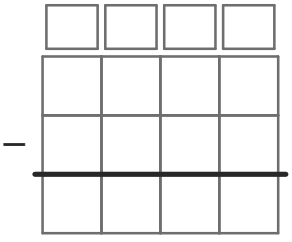

11 2639 − 2391 = ＿＿＿＿

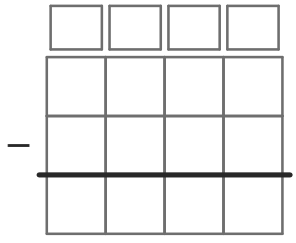

12 1007 − 157 = ＿＿＿＿

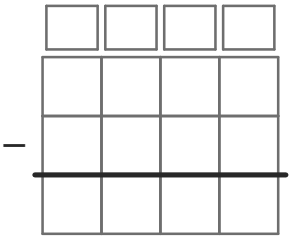

いちごドリル プリント

つづきの無料プリント
「小3のたし算とひき算の…」のプリント一覧がひらきます