小3 たし算の筆算 そうごうテスト（その1）

なまえ ＿＿＿＿＿＿＿＿

全12問 100点

ひづけ ＿＿＿＿＿＿ /100

筆算のマスを使ってとく。答えは下線に書く

1 214 ＋ 157 ＝ ＿＿＿＿＿＿

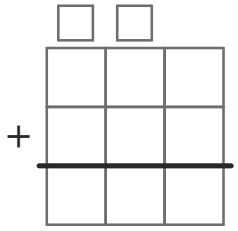

8点

2 258 ＋ 142 ＝ ＿＿＿＿＿＿

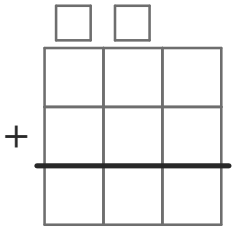

8点

3 389 ＋ 4897 ＝ ＿＿＿＿＿＿

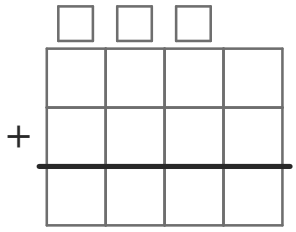

8点

4 7384 ＋ 5692 ＝ ＿＿＿＿＿＿

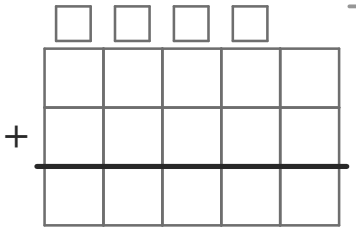

8点

5 3678 ＋ 4529 ＝ ＿＿＿＿＿＿

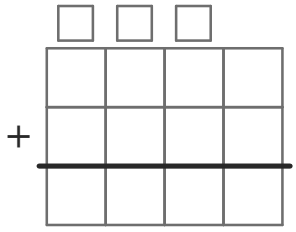

8点

6 385 ＋ 276 ＝ ＿＿＿＿＿＿

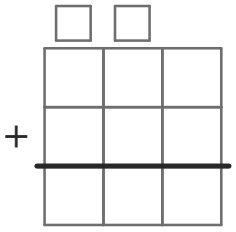

8点

7 568 ＋ 394 ＝ ＿＿＿＿＿＿

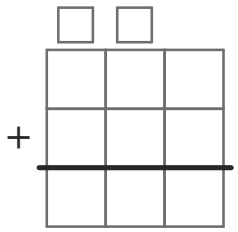

8点

8 258 ＋ 3476 ＝ ＿＿＿＿＿＿

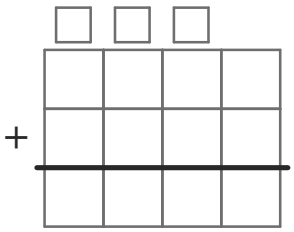

8点

9 2754 ＋ 5381 ＝ ＿＿＿＿＿＿

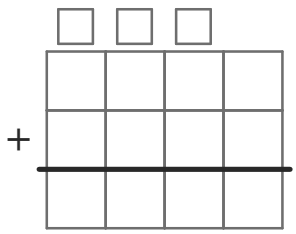

9点

10 6529 ＋ 4783 ＝ ＿＿＿＿＿＿

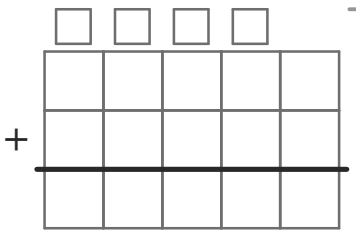

9点

11 125 ＋ 368 ＝ ＿＿＿＿＿＿

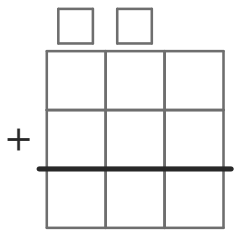

9点

12 463 ＋ 217 ＝ ＿＿＿＿＿＿

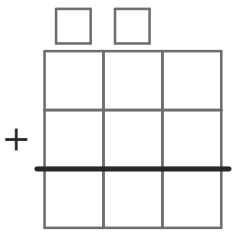

9点

小3 たし算の筆算 とっくんドリル①-1

なまえ ＿＿＿＿＿＿＿＿

くり上がりを、わすれずに足す 全8問

ひづけ ＿＿＿＿＿＿＿＿

筆算のマスを使ってとく。くり上がりは、次のくらいの上の小さなマスに書く。答えは下線に書く

1 314 + 446 = ＿＿＿＿＿＿

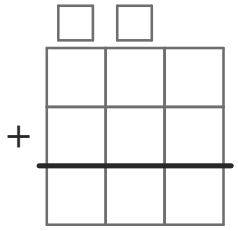

2 366 + 358 = ＿＿＿＿＿＿

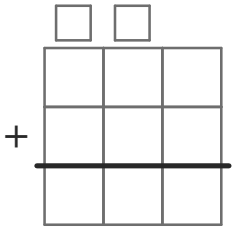

3 145 + 539 = ＿＿＿＿＿＿

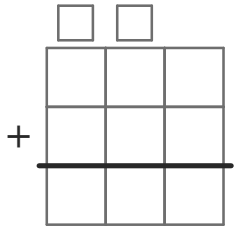

4 659 + 176 = ＿＿＿＿＿＿

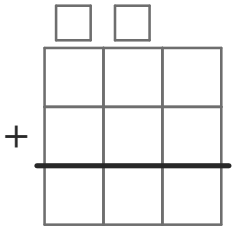

5 635 + 359 = ＿＿＿＿＿＿

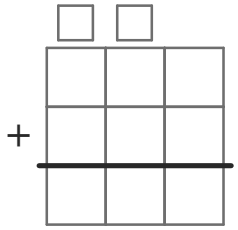

6 558 + 245 = ＿＿＿＿＿＿

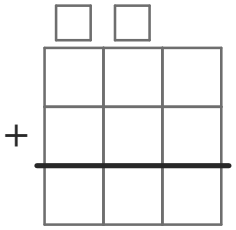

7 859 + 114 = ＿＿＿＿＿＿

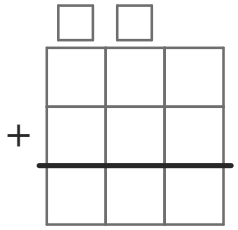

8 572 + 239 = ＿＿＿＿＿＿

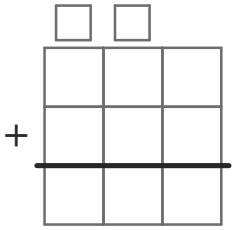

小3 たし算の筆算 とっくんドリル①-2

なまえ ＿＿＿＿＿＿＿＿

くり上がりを、わすれずに足す 全8問

ひづけ ＿＿＿＿＿＿＿＿

筆算のマスを使ってとく。くり上がりは、次のくらいの上の小さなマスに書く。答えは下線に書く

1 552 + 328 = ＿＿＿＿＿＿

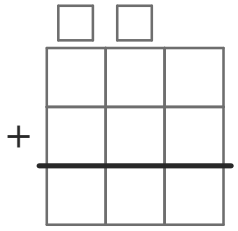

2 386 + 127 = ＿＿＿＿＿＿

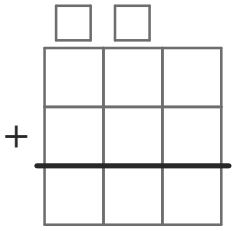

3 447 + 144 = ＿＿＿＿＿＿

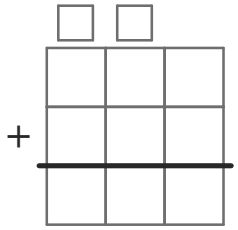

4 566 + 187 = ＿＿＿＿＿＿

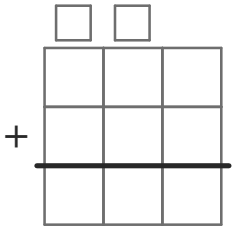

5 259 + 731 = ＿＿＿＿＿＿

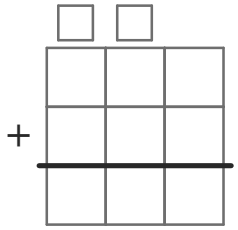

6 227 + 186 = ＿＿＿＿＿＿

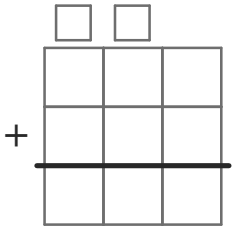

7 259 + 122 = ＿＿＿＿＿＿

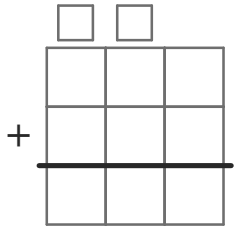

8 394 + 546 = ＿＿＿＿＿＿

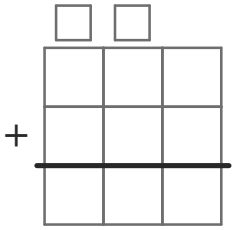

小3 たし算の筆算 とっくんドリル①-3

なまえ ＿＿＿＿＿＿＿＿

くり上がりを、わすれずに足す 全8問

ひづけ ＿＿＿＿＿＿＿＿

筆算のマスを使ってとく。くり上がりは、次のくらいの上の小さなマスに書く。答えは下線に書く

1 729 + 266 = ＿＿＿＿＿＿

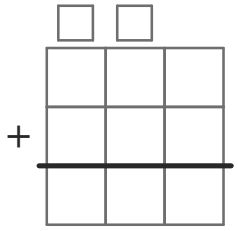

2 199 + 117 = ＿＿＿＿＿＿

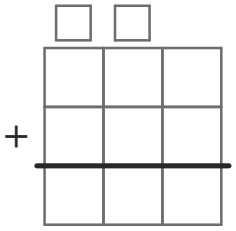

3 223 + 367 = ＿＿＿＿＿＿

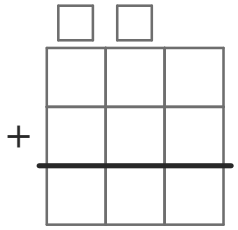

4 335 + 196 = ＿＿＿＿＿＿

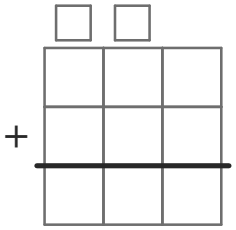

5 432 + 249 = ＿＿＿＿＿＿

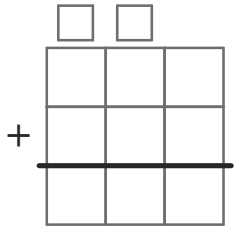

6 177 + 129 = ＿＿＿＿＿＿

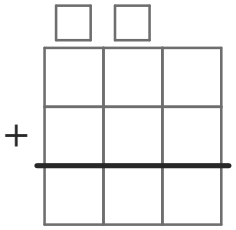

7 329 + 253 = ＿＿＿＿＿＿

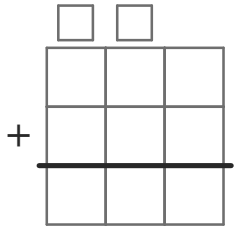

8 158 + 454 = ＿＿＿＿＿＿

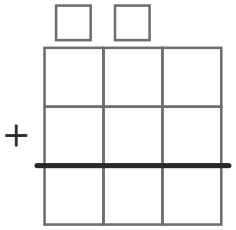

小3 たし算の筆算 とっくんドリル①-4

なまえ ＿＿＿＿＿＿＿＿

くり上がりを、わすれずに足す 全8問

ひづけ ＿＿＿＿＿＿＿＿

筆算のマスを使ってとく。くり上がりは、次のくらいの上の小さなマスに書く。答えは下線に書く

1 527 + 265 = ＿＿＿＿＿＿

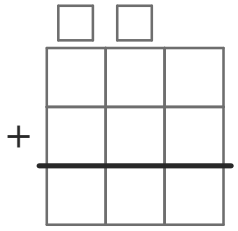

2 469 + 167 = ＿＿＿＿＿＿

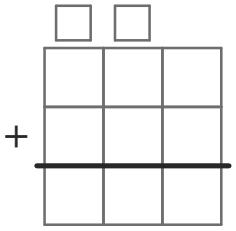

3 326 + 256 = ＿＿＿＿＿＿

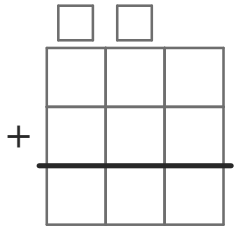

4 269 + 486 = ＿＿＿＿＿＿

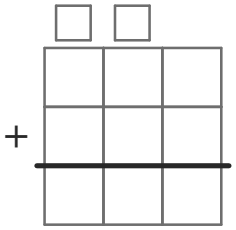

5 318 + 316 = ＿＿＿＿＿＿

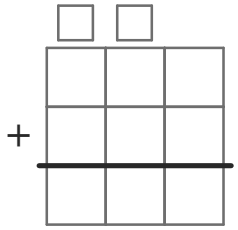

6 179 + 748 = ＿＿＿＿＿＿

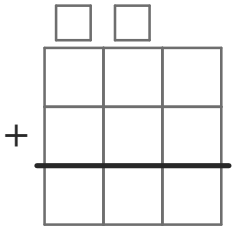

7 212 + 548 = ＿＿＿＿＿＿

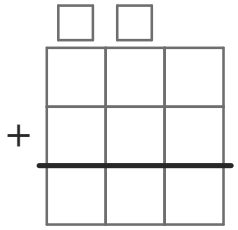

8 186 + 645 = ＿＿＿＿＿＿

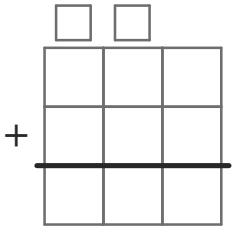

小3 たし算の筆算 とっくんドリル①-5

なまえ ＿＿＿＿＿＿＿＿

くり上がりを、わすれずに足す 全8問

ひづけ ＿＿＿＿＿＿＿＿

筆算のマスを使ってとく。くり上がりは、次のくらいの上の小さなマスに書く。答えは下線に書く

1 637 + 115 = ＿＿＿＿＿＿

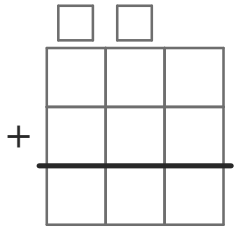

2 346 + 356 = ＿＿＿＿＿＿

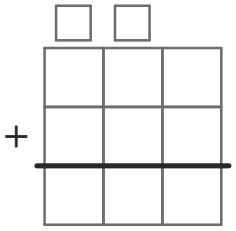

3 425 + 439 = ＿＿＿＿＿＿

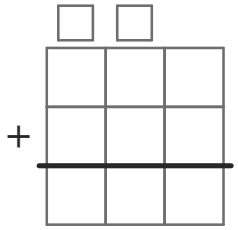

4 149 + 797 = ＿＿＿＿＿＿

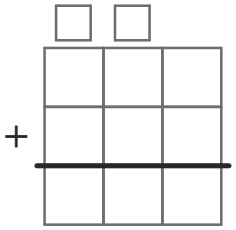

5 739 + 211 = ＿＿＿＿＿＿

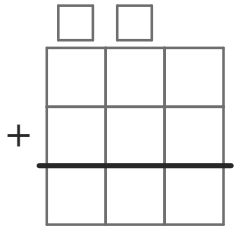

6 118 + 699 = ＿＿＿＿＿＿

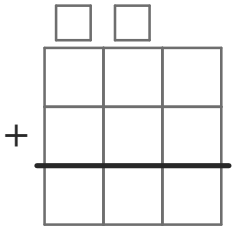

7 118 + 353 = ＿＿＿＿＿＿

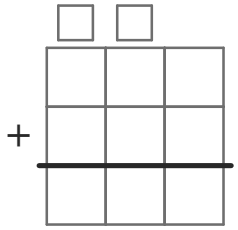

8 286 + 345 = ＿＿＿＿＿＿

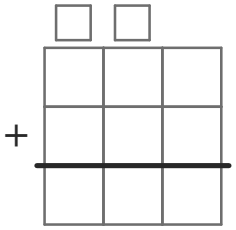

小3 たし算の筆算 とっくんドリル②-1

千・万へ くり上がる 全8問

なまえ ＿＿＿＿＿＿＿＿

ひづけ ＿＿＿＿＿＿＿＿

4けたの筆算のマスを使ってとく。千の上の小さなマスや、万のくらいにも1を書く。答えは下線に書く

1 5912 ＋ 2918 ＝ ＿＿＿＿

□ □ □

＋

2 5392 ＋ 7864 ＝ ＿＿＿＿

□ □ □ □

＋

3 5577 ＋ 2773 ＝ ＿＿＿＿

□ □ □

＋

4 7565 ＋ 5191 ＝ ＿＿＿＿

□ □ □ □

＋

5 2728 ＋ 1666 ＝ ＿＿＿＿

□ □ □

＋

6 7315 ＋ 9214 ＝ ＿＿＿＿

□ □ □ □

＋

7 5921 ＋ 1374 ＝ ＿＿＿＿

□ □ □

＋

8 8174 ＋ 6491 ＝ ＿＿＿＿

□ □ □ □

＋

小3 たし算の筆算 とっくんドリル②-2

千・万へ くり上がる 全8問

なまえ ＿＿＿＿＿＿＿＿

ひづけ ＿＿＿＿＿＿＿＿

4けたの筆算のマスを使ってとく。千の上の小さなマスや、万のくらいにも1を書く。答えは下線に書く

1 3882 ＋ 5388 ＝ ＿＿＿＿

□ □ □

＋

2 5188 ＋ 6948 ＝ ＿＿＿＿

□ □ □ □

＋

3 1784 ＋ 1727 ＝ ＿＿＿＿

□ □ □

＋

4 6811 ＋ 4258 ＝ ＿＿＿＿

□ □ □ □

＋

5 5998 ＋ 3147 ＝ ＿＿＿＿

□ □ □

＋

6 3422 ＋ 8198 ＝ ＿＿＿＿

□ □ □ □

＋

7 7678 ＋ 1472 ＝ ＿＿＿＿

□ □ □

＋

8 8946 ＋ 7797 ＝ ＿＿＿＿

□ □ □ □

＋

小3 たし算の筆算 とっくんドリル②-3

千・万へ くり上がる 全8問

なまえ ＿＿＿＿＿＿＿＿

ひづけ ＿＿＿＿＿＿＿＿

4けたの筆算のマスを使ってとく。千の上の小さなマスや、万のくらいにも1を書く。答えは下線に書く

1 4486 ＋ 2557 ＝ ＿＿＿＿

□ □ □

＋

2 4674 ＋ 8458 ＝ ＿＿＿＿

□ □ □ □

＋

3 5817 ＋ 2669 ＝ ＿＿＿＿

□ □ □

＋

4 8181 ＋ 8784 ＝ ＿＿＿＿

□ □ □ □

＋

5 1873 ＋ 6774 ＝ ＿＿＿＿

□ □ □

＋

6 7474 ＋ 5382 ＝ ＿＿＿＿

□ □ □ □

＋

7 3742 ＋ 1825 ＝ ＿＿＿＿

□ □ □

＋

8 8962 ＋ 7658 ＝ ＿＿＿＿

□ □ □ □

＋

小3 たし算の筆算 とっくんドリル②-4

千・万へ くり上がる 全8問

なまえ ＿＿＿＿＿＿＿＿

ひづけ ＿＿＿＿＿＿＿＿

4けたの筆算のマスを使ってとく。千の上の小さなマスや、万のくらいにも1を書く。答えは下線に書く

1 2394 ＋ 1988 ＝ ＿＿＿＿

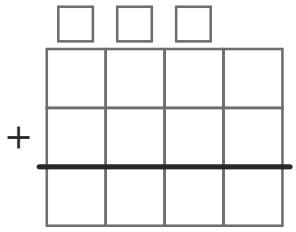

2 8879 ＋ 7623 ＝ ＿＿＿＿

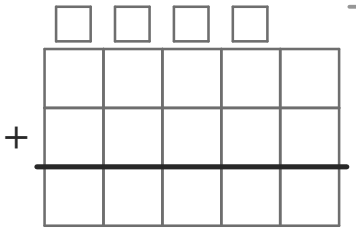

3 1113 ＋ 7974 ＝ ＿＿＿＿

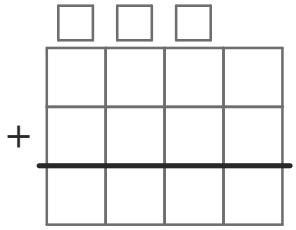

4 4769 ＋ 9732 ＝ ＿＿＿＿

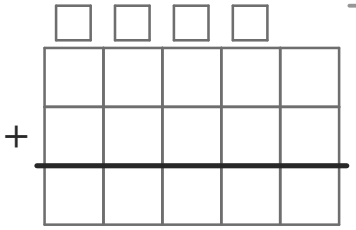

5 2385 ＋ 2789 ＝ ＿＿＿＿

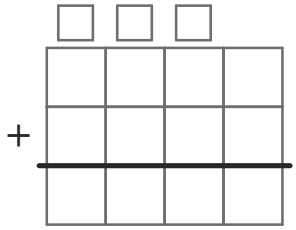

6 9465 ＋ 9732 ＝ ＿＿＿＿

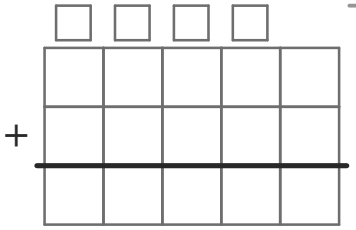

7 5352 ＋ 1877 ＝ ＿＿＿＿

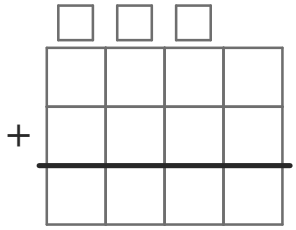

8 4474 ＋ 9911 ＝ ＿＿＿＿

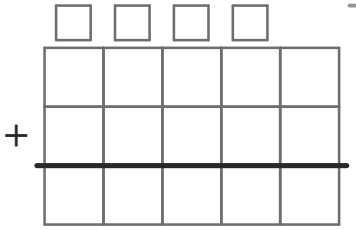

小3 たし算の筆算 とっくんドリル②-5

千・万へ くり上がる 全8問

なまえ ＿＿＿＿＿＿＿＿

ひづけ ＿＿＿＿＿＿＿＿

4けたの筆算のマスを使ってとく。千の上の小さなマスや、万のくらいにも1を書く。答えは下線に書く

1 5985 ＋ 2964 ＝ ＿＿＿＿

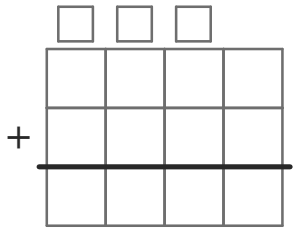

2 9738 ＋ 7462 ＝ ＿＿＿＿

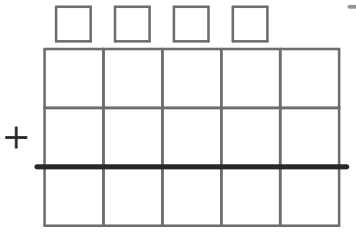

3 3776 ＋ 5328 ＝ ＿＿＿＿

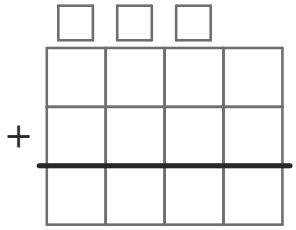

4 6177 ＋ 7586 ＝ ＿＿＿＿

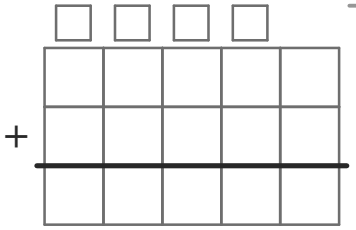

5 3921 ＋ 3453 ＝ ＿＿＿＿

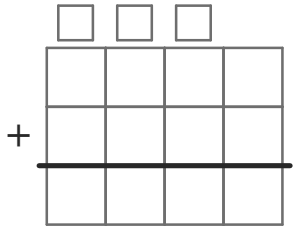

6 9361 ＋ 2214 ＝ ＿＿＿＿

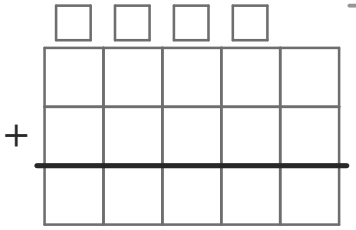

7 3898 ＋ 5671 ＝ ＿＿＿＿

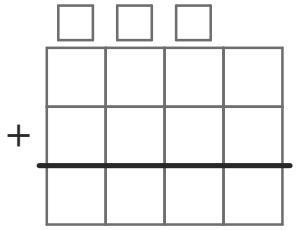

8 9585 ＋ 2562 ＝ ＿＿＿＿

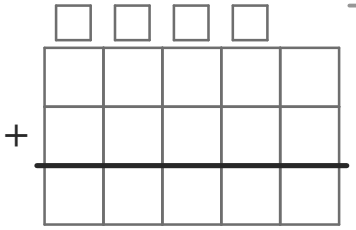

小3 たし算の筆算 とっくんドリル③-1

なまえ ＿＿＿＿＿＿＿＿

くらいをそろえる･10に なる 全12問

ひづけ ＿＿＿＿＿＿＿＿

筆算のマスを使ってとく。答えは下線に書く。たした数が10になったら、0を書いて1を上げる

1 544 + 41 = ＿＿＿＿

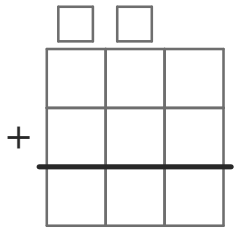

2 790 + 916 = ＿＿＿＿

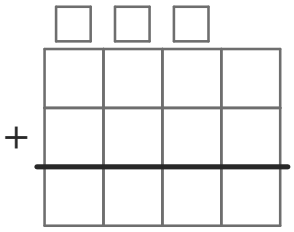

3 833 + 4 = ＿＿＿＿

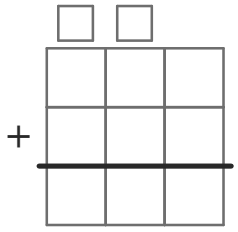

4 1621 + 339 = ＿＿＿＿

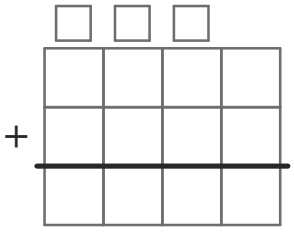

5 1783 + 8 = ＿＿＿＿

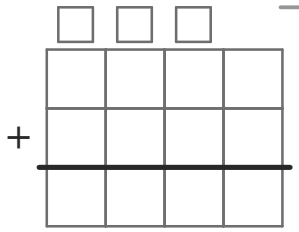

6 511 + 791 = ＿＿＿＿

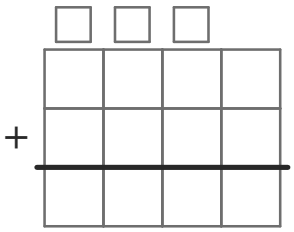

7 69 + 7948 = ＿＿＿＿

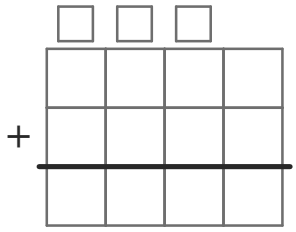

8 558 + 562 = ＿＿＿＿

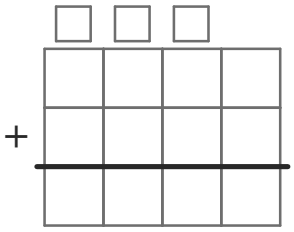

9 1531 + 717 = ＿＿＿＿

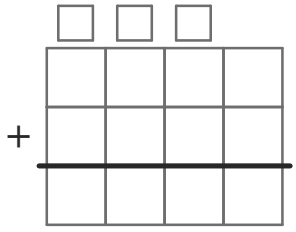

10 6143 + 447 = ＿＿＿＿

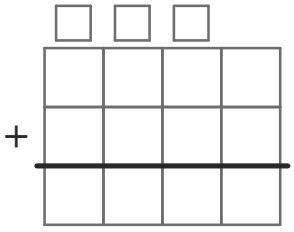

11 951 + 41 = ＿＿＿＿

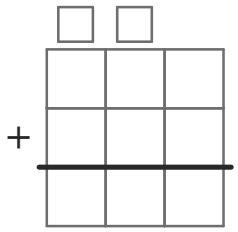

12 444 + 486 = ＿＿＿＿

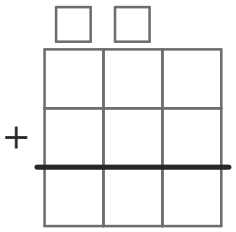

小3 たし算の筆算 とっくんドリル③-2

なまえ ＿＿＿＿＿＿＿＿

くらいをそろえる･10に なる 全12問

ひづけ ＿＿＿＿＿＿＿＿

筆算のマスを使ってとく。答えは下線に書く。たした数が10になったら、0を書いて1を上げる

1 641 + 64 = ＿＿＿＿

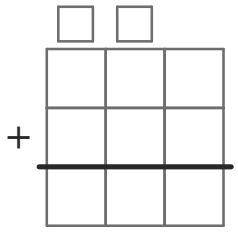

2 975 + 735 = ＿＿＿＿

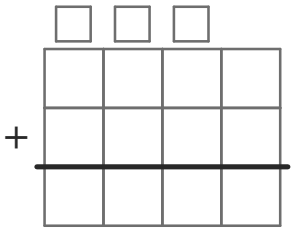

3 83 + 132 = ＿＿＿＿

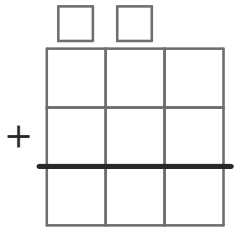

4 355 + 549 = ＿＿＿＿

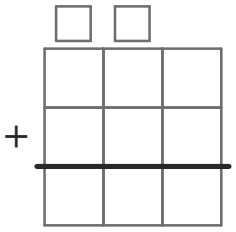

5 5183 + 4 = ＿＿＿＿

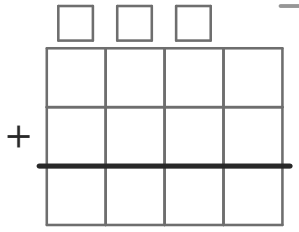

6 4253 + 156 = ＿＿＿＿

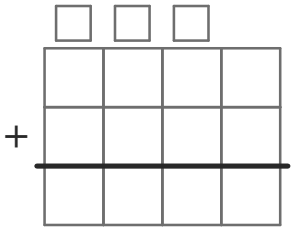

7 776 + 84 = ＿＿＿＿

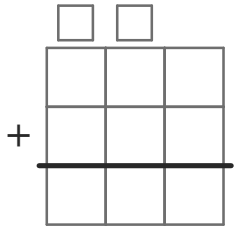

8 348 + 562 = ＿＿＿＿

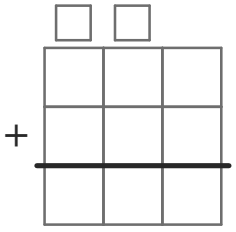

9 9396 + 25 = ＿＿＿＿

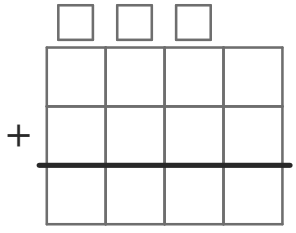

10 5205 + 205 = ＿＿＿＿

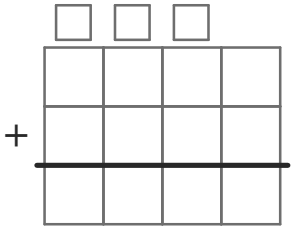

11 6459 + 49 = ＿＿＿＿

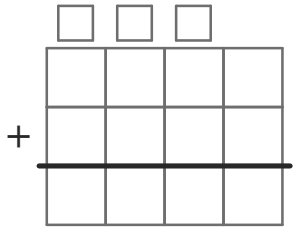

12 324 + 856 = ＿＿＿＿

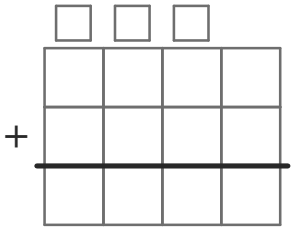

小3 たし算の筆算 とっくんドリル③-3

なまえ ＿＿＿＿＿＿＿＿

くらいをそろえる･10に なる 全12問

ひづけ ＿＿＿＿＿＿＿＿

筆算のマスを使ってとく。答えは下線に書く。たした数が10になったら、0を書いて1を上げる

1 921 + 6 = ＿＿＿＿

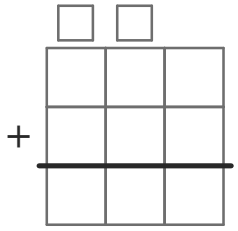

2 290 + 414 = ＿＿＿＿

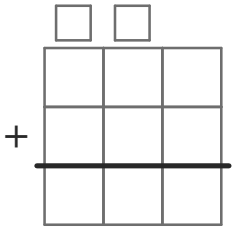

3 399 + 96 = ＿＿＿＿

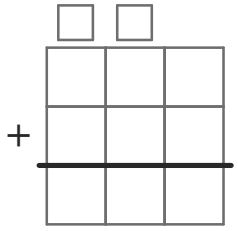

4 686 + 544 = ＿＿＿＿

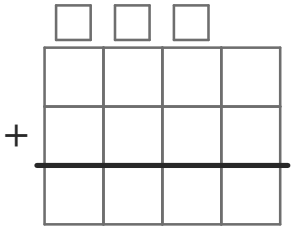

5 994 + 9 = ＿＿＿＿

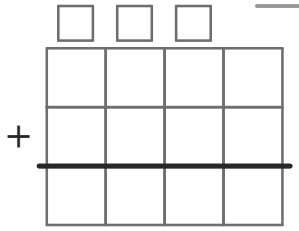

6 156 + 674 = ＿＿＿＿

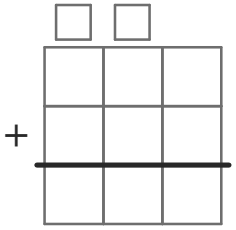

7 6695 + 1 = ＿＿＿＿

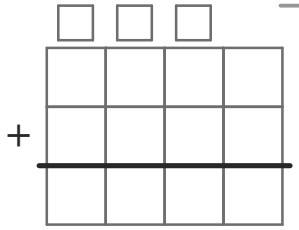

8 448 + 462 = ＿＿＿＿

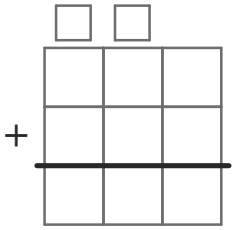

9 79 + 393 = ＿＿＿＿

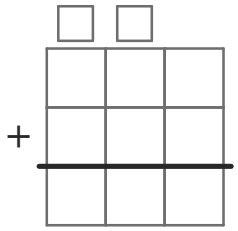

10 4553 + 751 = ＿＿＿＿

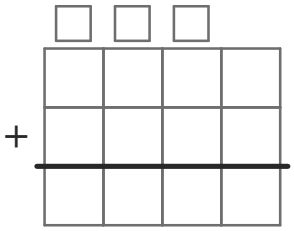

11 475 + 1925 = ＿＿＿＿

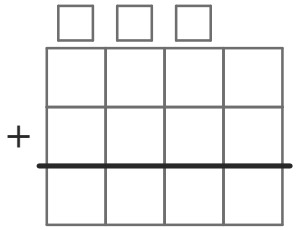

12 741 + 667 = ＿＿＿＿

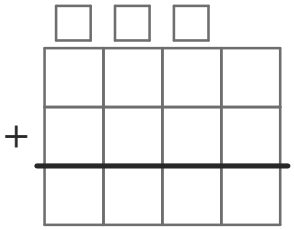

小3 たし算の筆算 とっくんドリル③-4

なまえ ＿＿＿＿＿＿＿＿

くらいをそろえる･10に なる 全12問

ひづけ ＿＿＿＿＿＿＿＿

筆算のマスを使ってとく。答えは下線に書く。たした数が10になったら、0を書いて1を上げる

1 87 + 6818 = ＿＿＿＿

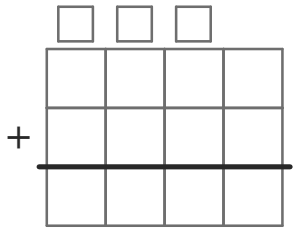

2 381 + 799 = ＿＿＿＿

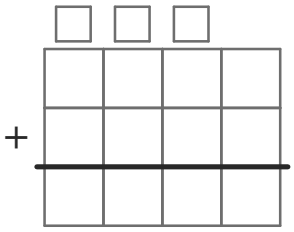

3 6784 + 863 = ＿＿＿＿

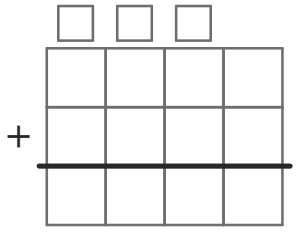

4 171 + 339 = ＿＿＿＿

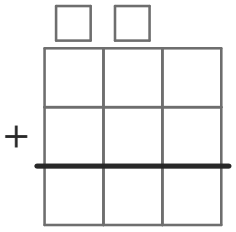

5 33 + 983 = ＿＿＿＿

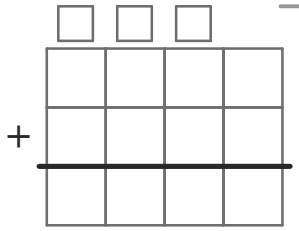

6 3929 + 251 = ＿＿＿＿

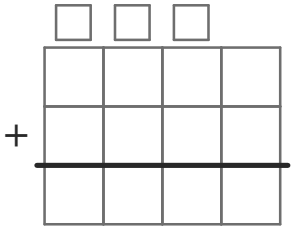

7 8935 + 77 = ＿＿＿＿

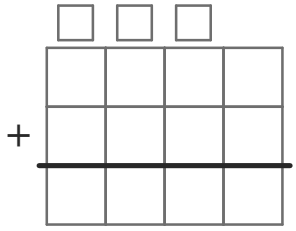

8 561 + 169 = ＿＿＿＿

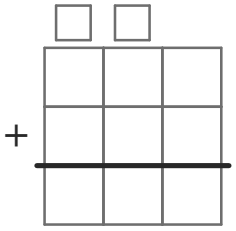

9 1 + 979 = ＿＿＿＿

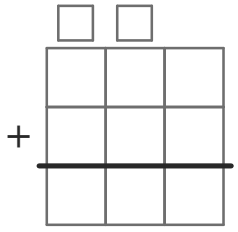

10 1969 + 80 = ＿＿＿＿

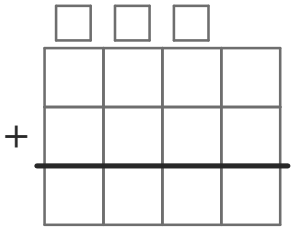

11 537 + 2383 = ＿＿＿＿

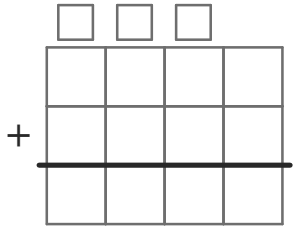

12 738 + 182 = ＿＿＿＿

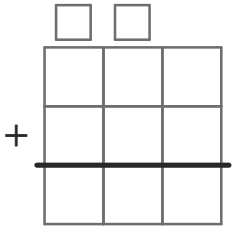

小3 たし算の筆算 とっくんドリル③-5

なまえ ＿＿＿＿＿＿＿＿

くらいをそろえる･10に なる 全12問

ひづけ ＿＿＿＿＿＿＿＿

筆算のマスを使ってとく。答えは下線に書く。たした数が10になったら、0を書いて1を上げる

1 86 + 277 = ＿＿＿＿

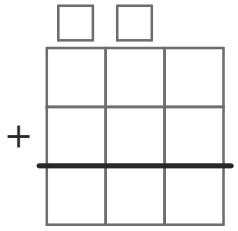

2 397 + 305 = ＿＿＿＿

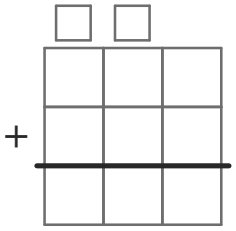

3 92 + 623 = ＿＿＿＿

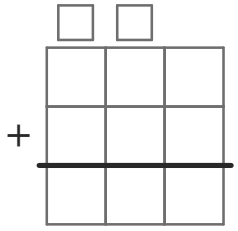

4 4214 + 336 = ＿＿＿＿

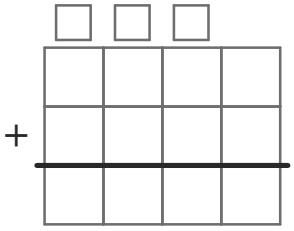

5 39 + 776 = ＿＿＿＿

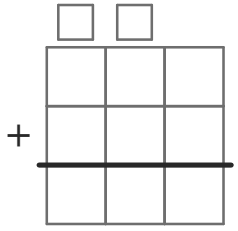

6 478 + 792 = ＿＿＿＿

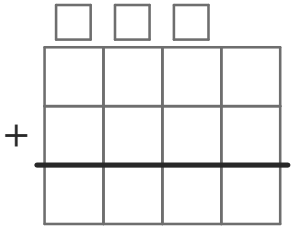

7 3192 + 17 = ＿＿＿＿

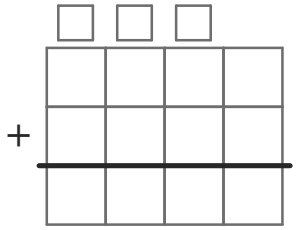

8 5023 + 147 = ＿＿＿＿

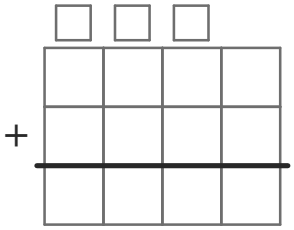

9 5875 + 478 = ＿＿＿＿

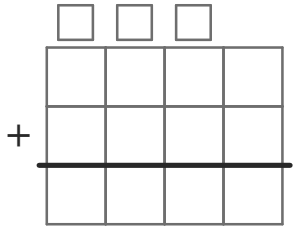

10 2303 + 4721 = ＿＿＿＿

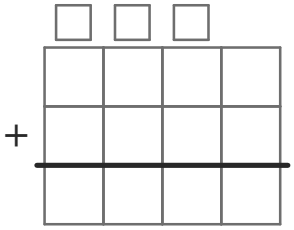

11 5 + 523 = ＿＿＿＿

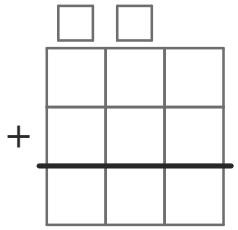

12 3763 + 738 = ＿＿＿＿

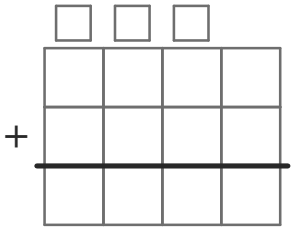

小3 たし算の筆算 そうごうテスト（その2）

なまえ ＿＿＿＿＿＿＿＿

全12問 100点

ひづけ ＿＿＿＿＿＿ /100

筆算のマスを使ってとく。答えは下線に書く

1 215 ＋ 135 ＝ ＿＿＿＿＿＿

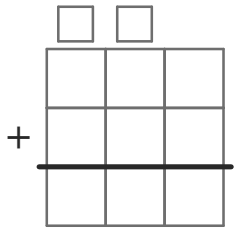

8点

2 7342 ＋ 7899 ＝ ＿＿＿＿＿＿

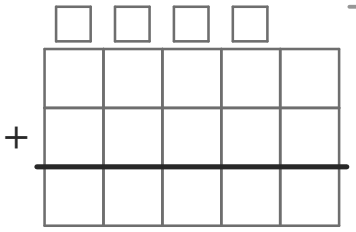

8点

3 259 ＋ 29 ＝ ＿＿＿＿＿＿

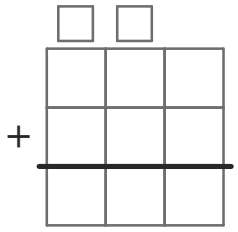

8点

4 668 ＋ 144 ＝ ＿＿＿＿＿＿

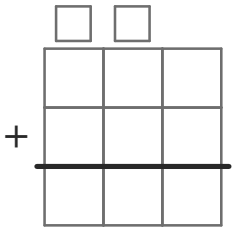

8点

5 6893 ＋ 2745 ＝ ＿＿＿＿＿＿

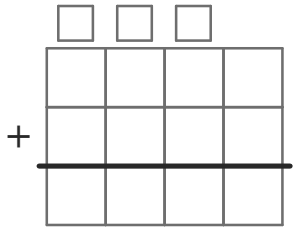

8点

6 135 ＋ 819 ＝ ＿＿＿＿＿＿

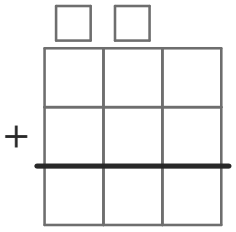

8点

7 5671 ＋ 2879 ＝ ＿＿＿＿＿＿

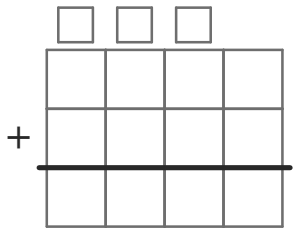

8点

8 257 ＋ 549 ＝ ＿＿＿＿＿＿

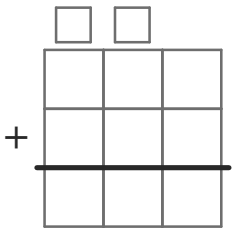

8点

9 4711 ＋ 6518 ＝ ＿＿＿＿＿＿

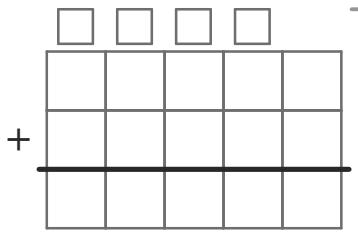

9点

10 239 ＋ 142 ＝ ＿＿＿＿＿＿

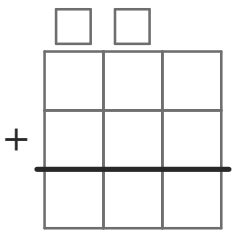

9点

11 5407 ＋ 943 ＝ ＿＿＿＿＿＿

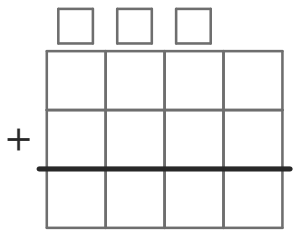

9点

12 6462 ＋ 3 ＝ ＿＿＿＿＿＿

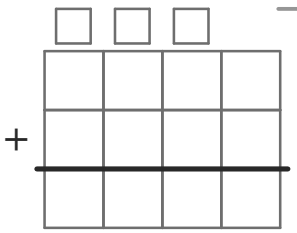

9点

小3 たし算の筆算 そうごうテスト（その3）

なまえ ＿＿＿＿＿＿＿＿

全12問 100点

ひづけ ＿＿＿＿＿＿ /100

筆算のマスを使ってとく。答えは下線に書く

1 547 ＋ 159 ＝ ＿＿＿＿＿＿

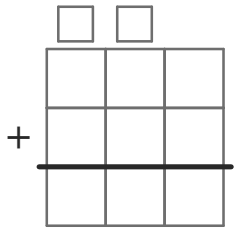

8点

2 3827 ＋ 5387 ＝ ＿＿＿＿＿＿

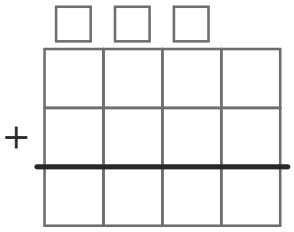

8点

3 99 ＋ 676 ＝ ＿＿＿＿＿＿

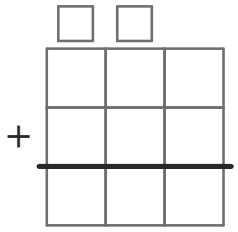

8点

4 316 ＋ 787 ＝ ＿＿＿＿＿＿

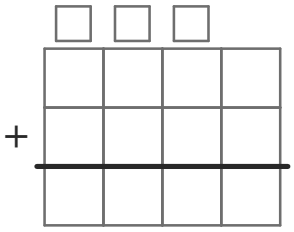

8点

5 145 ＋ 327 ＝ ＿＿＿＿＿＿

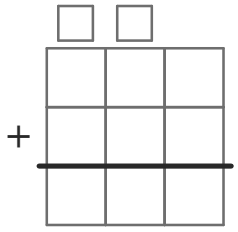

8点

6 9375 ＋ 5171 ＝ ＿＿＿＿＿＿

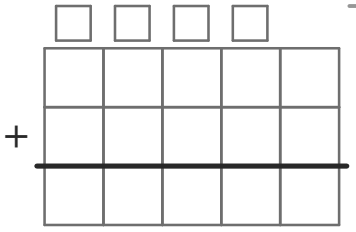

8点

7 548 ＋ 346 ＝ ＿＿＿＿＿＿

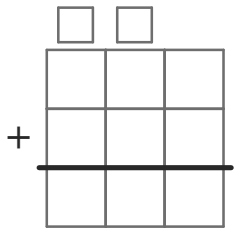

8点

8 323 ＋ 3671 ＝ ＿＿＿＿＿＿

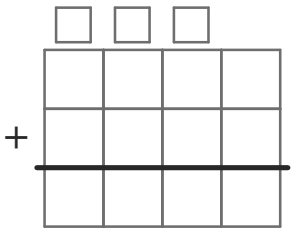

8点

9 3132 ＋ 73 ＝ ＿＿＿＿＿＿

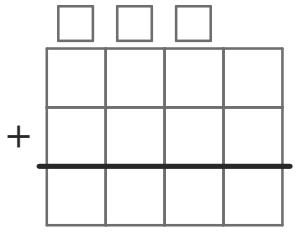

9点

10 262 ＋ 369 ＝ ＿＿＿＿＿＿

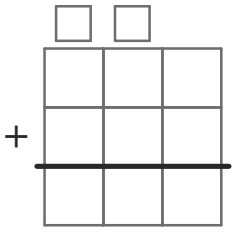

9点

11 1687 ＋ 2727 ＝ ＿＿＿＿＿＿

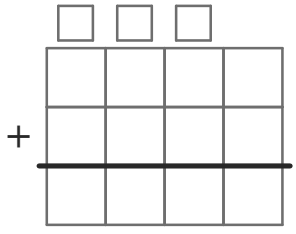

9点

12 7828 ＋ 6847 ＝ ＿＿＿＿＿＿

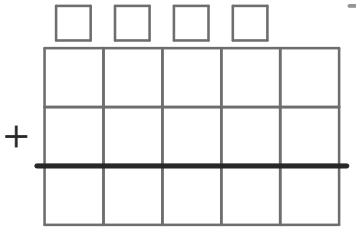

9点

小3 たし算の筆算 そうごうテスト（その4）

なまえ ＿＿＿＿＿＿＿＿

全12問 100点

ひづけ ＿＿＿＿＿＿ /100

筆算のマスを使ってとく。答えは下線に書く

1 457 + 228 = ＿＿＿＿＿＿

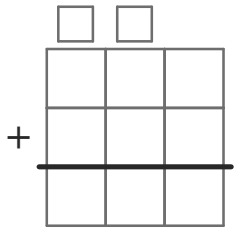

8点

2 61 + 571 = ＿＿＿＿＿＿

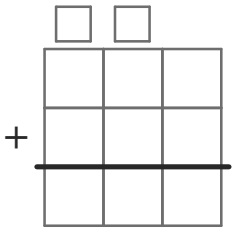

8点

3 6868 + 8782 = ＿＿＿＿＿＿

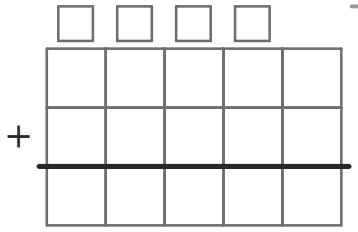

8点

4 4854 + 4151 = ＿＿＿＿＿＿

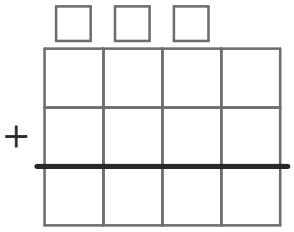

8点

5 556 + 265 = ＿＿＿＿＿＿

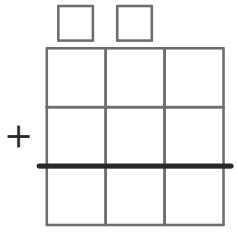

8点

6 366 + 404 = ＿＿＿＿＿＿

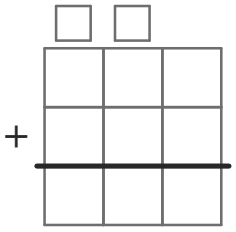

8点

7 722 + 219 = ＿＿＿＿＿＿

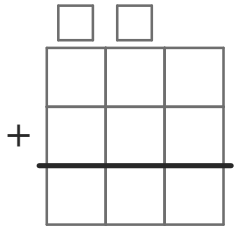

8点

8 177 + 427 = ＿＿＿＿＿＿

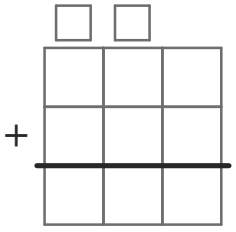

8点

9 533 + 347 = ＿＿＿＿＿＿

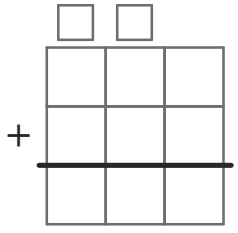

9点

10 3524 + 9627 = ＿＿＿＿＿＿

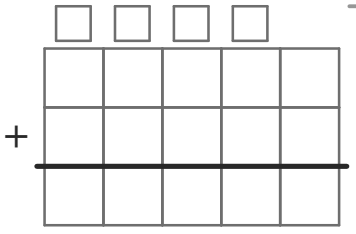

9点

11 6165 + 47 = ＿＿＿＿＿＿

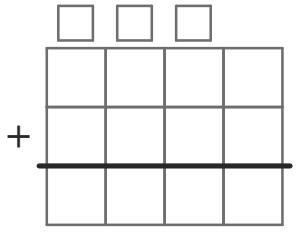

9点

12 1636 + 1879 = ＿＿＿＿＿＿

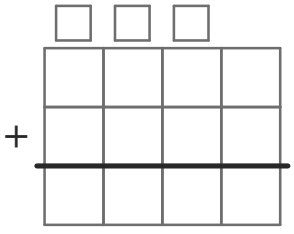

9点

小3 たし算の筆算 そうごうテスト（その5）

なまえ ＿＿＿＿＿＿＿＿

全12問 100点

ひづけ ＿＿＿＿＿＿ /100

筆算のマスを使ってとく。答えは下線に書く

1 7935 + 6169 = ＿＿＿＿＿＿

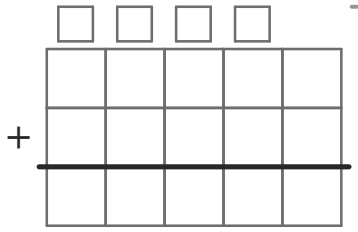

8点

2 823 + 139 = ＿＿＿＿＿＿

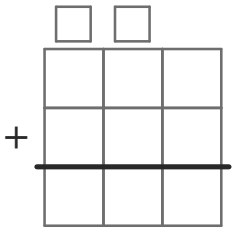

8点

3 5477 + 2647 = ＿＿＿＿＿＿

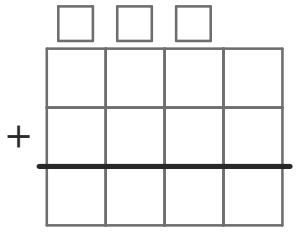

8点

4 359 + 347 = ＿＿＿＿＿＿

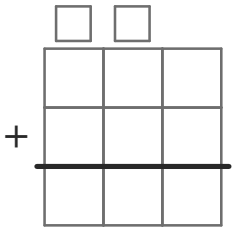

8点

5 314 + 826 = ＿＿＿＿＿＿

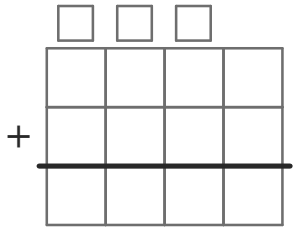

8点

6 9936 + 173 = ＿＿＿＿＿＿

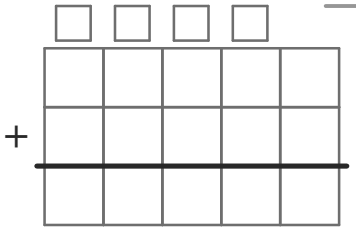

8点

7 234 + 417 = ＿＿＿＿＿＿

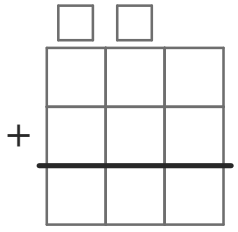

8点

8 924 + 981 = ＿＿＿＿＿＿

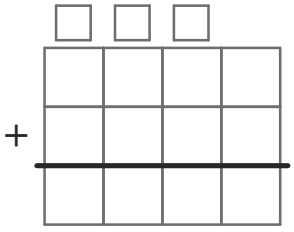

8点

9 194 + 276 = ＿＿＿＿＿＿

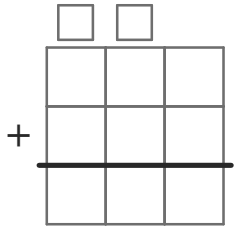

9点

10 963 + 9125 = ＿＿＿＿＿＿

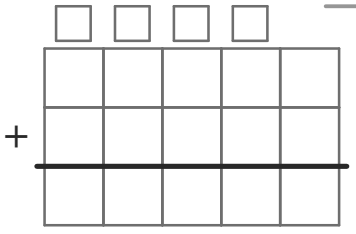

9点

11 5275 + 9655 = ＿＿＿＿＿＿

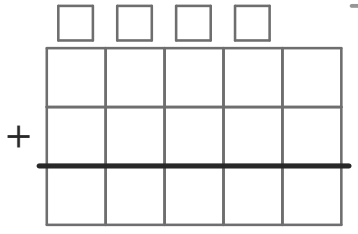

9点

12 2249 + 1966 = ＿＿＿＿＿＿

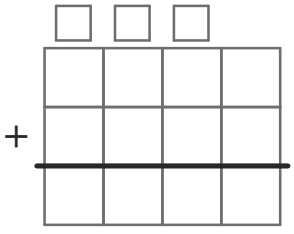

9点