小3 たし算の筆算 とっくんドリル③-5

なまえ ＿＿＿＿＿＿＿＿

くらいをそろえる･10に なる 全12問

ひづけ ＿＿＿＿＿＿＿＿

筆算のマスを使ってとく。答えは下線に書く。たした数が10になったら、0を書いて1を上げる

1 86 + 277 = ＿＿＿＿

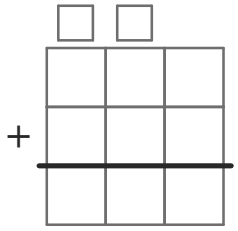

2 397 + 305 = ＿＿＿＿

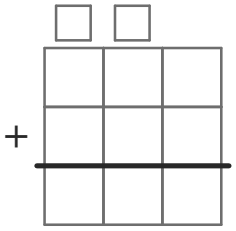

3 92 + 623 = ＿＿＿＿

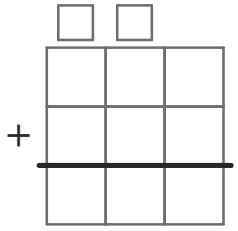

4 4214 + 336 = ＿＿＿＿

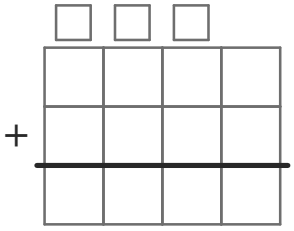

5 39 + 776 = ＿＿＿＿

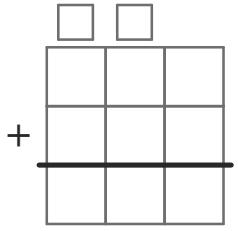

6 478 + 792 = ＿＿＿＿

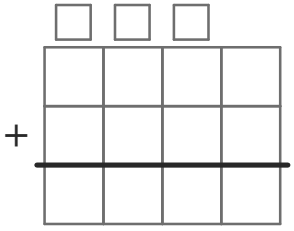

7 3192 + 17 = ＿＿＿＿

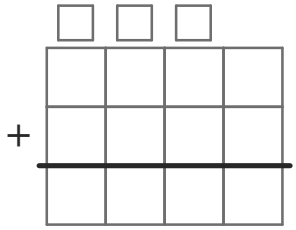

8 5023 + 147 = ＿＿＿＿

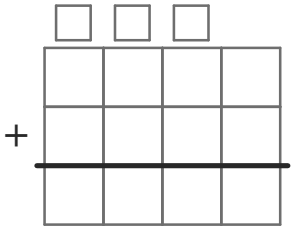

9 5875 + 478 = ＿＿＿＿

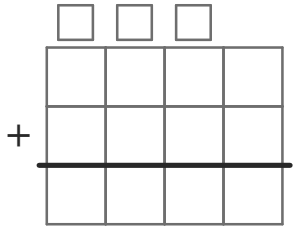

10 2303 + 4721 = ＿＿＿＿

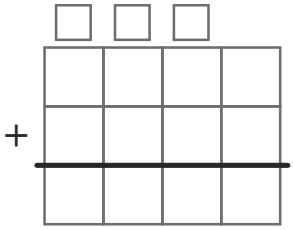

11 5 + 523 = ＿＿＿＿

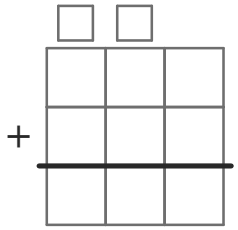

12 3763 + 738 = ＿＿＿＿

