小3 たし算の筆算 とっくんドリル③-3

なまえ ＿＿＿＿＿＿＿＿

くらいをそろえる･10に なる 全12問

ひづけ ＿＿＿＿＿＿＿＿

筆算のマスを使ってとく。答えは下線に書く。たした数が10になったら、0を書いて1を上げる

1 921 + 6 = ＿＿＿＿

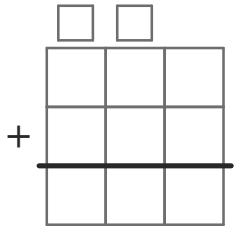

2 290 + 414 = ＿＿＿＿

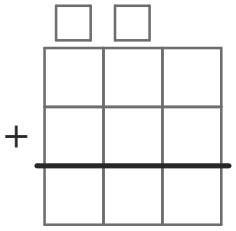

3 399 + 96 = ＿＿＿＿

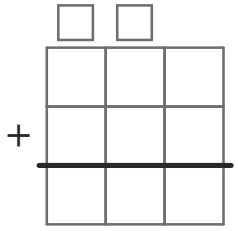

4 686 + 544 = ＿＿＿＿

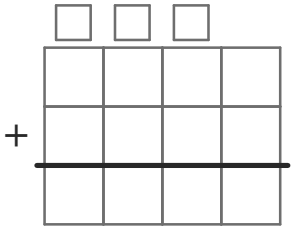

5 994 + 9 = ＿＿＿＿

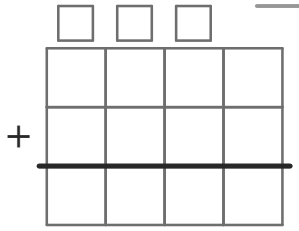

6 156 + 674 = ＿＿＿＿

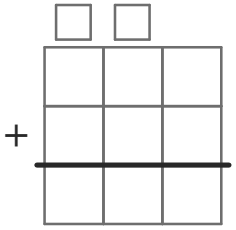

7 6695 + 1 = ＿＿＿＿

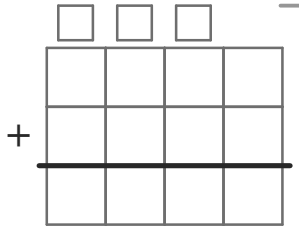

8 448 + 462 = ＿＿＿＿

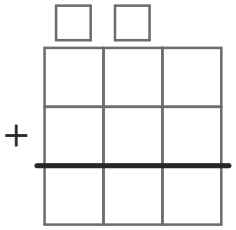

9 79 + 393 = ＿＿＿＿

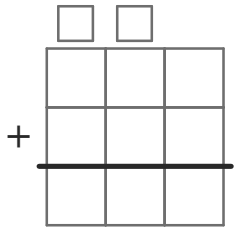

10 4553 + 751 = ＿＿＿＿

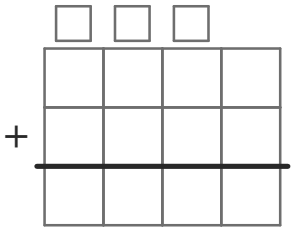

11 475 + 1925 = ＿＿＿＿

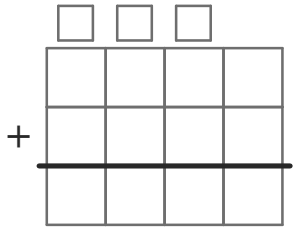

12 741 + 667 = ＿＿＿＿

