小3 たし算の筆算 とっくんドリル③-2

なまえ ＿＿＿＿＿＿＿＿

くらいをそろえる･10に なる 全12問

ひづけ ＿＿＿＿＿＿＿＿

筆算のマスを使ってとく。答えは下線に書く。たした数が10になったら、0を書いて1を上げる

1 641 + 64 = ＿＿＿＿

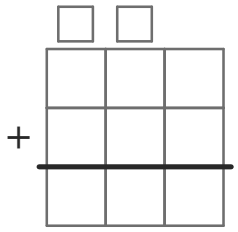

2 975 + 735 = ＿＿＿＿

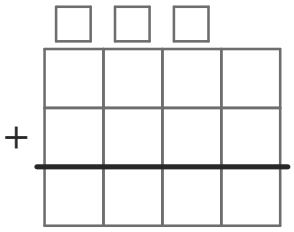

3 83 + 132 = ＿＿＿＿

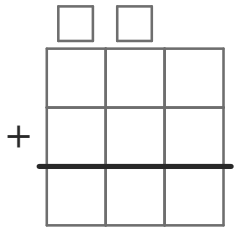

4 355 + 549 = ＿＿＿＿

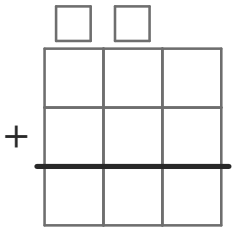

5 5183 + 4 = ＿＿＿＿

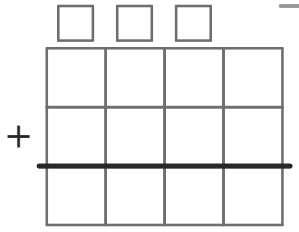

6 4253 + 156 = ＿＿＿＿

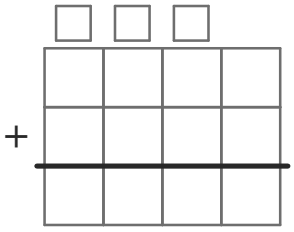

7 776 + 84 = ＿＿＿＿

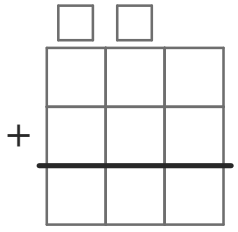

8 348 + 562 = ＿＿＿＿

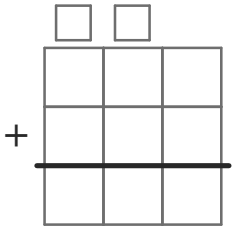

9 9396 + 25 = ＿＿＿＿

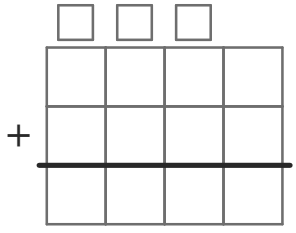

10 5205 + 205 = ＿＿＿＿

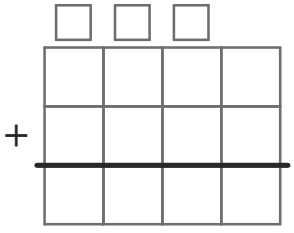

11 6459 + 49 = ＿＿＿＿

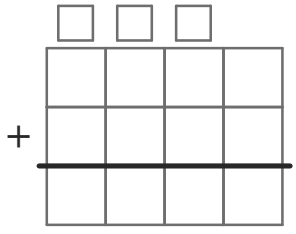

12 324 + 856 = ＿＿＿＿

