小3 たし算の筆算 とっくんドリル③-1

なまえ ＿＿＿＿＿＿＿＿

くらいをそろえる･10に なる 全12問

ひづけ ＿＿＿＿＿＿＿＿

筆算のマスを使ってとく。答えは下線に書く。たした数が10になったら、0を書いて1を上げる

1 544 + 41 = ＿＿＿＿

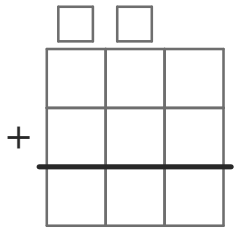

2 790 + 916 = ＿＿＿＿

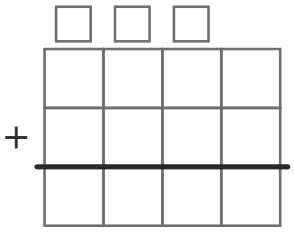

3 833 + 4 = ＿＿＿＿

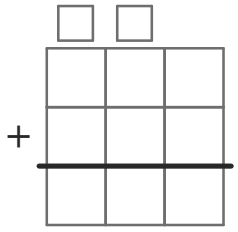

4 1621 + 339 = ＿＿＿＿

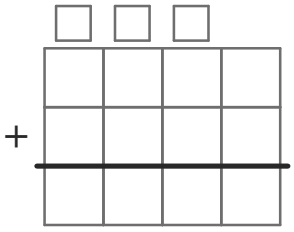

5 1783 + 8 = ＿＿＿＿

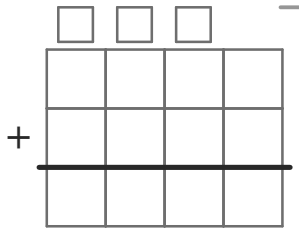

6 511 + 791 = ＿＿＿＿

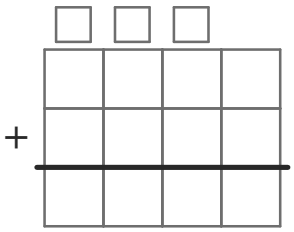

7 69 + 7948 = ＿＿＿＿

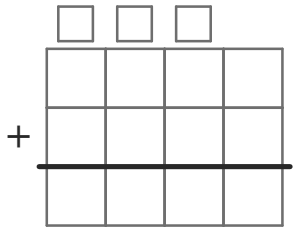

8 558 + 562 = ＿＿＿＿

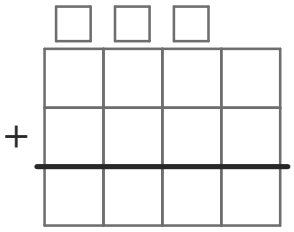

9 1531 + 717 = ＿＿＿＿

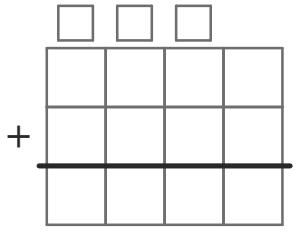

10 6143 + 447 = ＿＿＿＿

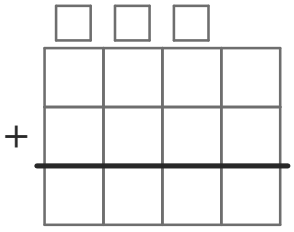

11 951 + 41 = ＿＿＿＿

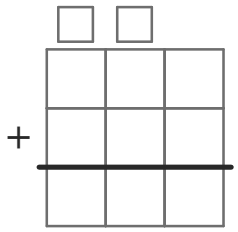

12 444 + 486 = ＿＿＿＿

