小3 たし算の筆算 とっくんドリル②-5

千・万へ くり上がる 全8問

なまえ ＿＿＿＿＿＿＿＿

ひづけ ＿＿＿＿＿＿＿＿

4けたの筆算のマスを使ってとく。千の上の小さなマスや、万のくらいにも1を書く。答えは下線に書く

1 5985 ＋ 2964 ＝ ＿＿＿＿

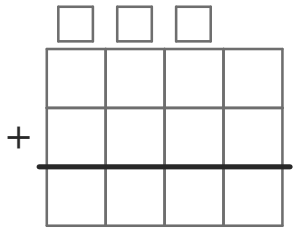

2 9738 ＋ 7462 ＝ ＿＿＿＿

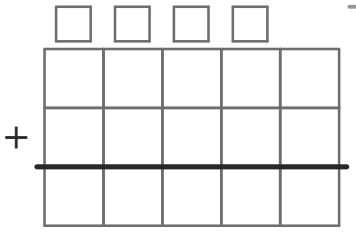

3 3776 ＋ 5328 ＝ ＿＿＿＿

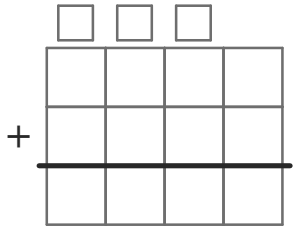

4 6177 ＋ 7586 ＝ ＿＿＿＿

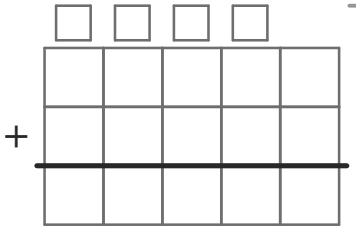

5 3921 ＋ 3453 ＝ ＿＿＿＿

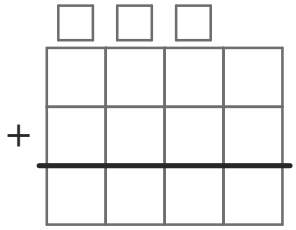

6 9361 ＋ 2214 ＝ ＿＿＿＿

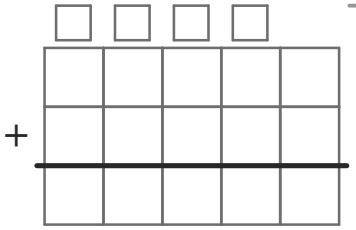

7 3898 ＋ 5671 ＝ ＿＿＿＿

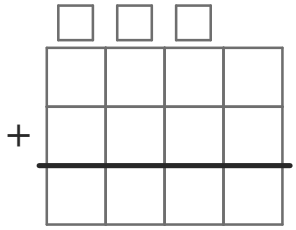

8 9585 ＋ 2562 ＝ ＿＿＿＿

