小3 たし算の筆算 とっくんドリル②-4

千・万へ くり上がる 全8問

なまえ ＿＿＿＿＿＿＿＿

ひづけ ＿＿＿＿＿＿＿＿

4けたの筆算のマスを使ってとく。千の上の小さなマスや、万のくらいにも1を書く。答えは下線に書く

1 2394 ＋ 1988 ＝ ＿＿＿＿

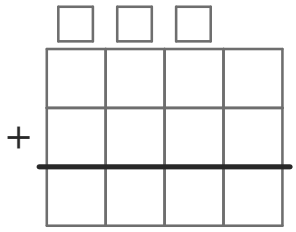

2 8879 ＋ 7623 ＝ ＿＿＿＿

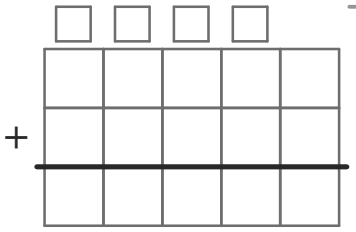

3 1113 ＋ 7974 ＝ ＿＿＿＿

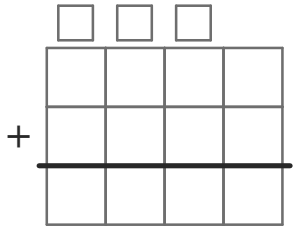

4 4769 ＋ 9732 ＝ ＿＿＿＿

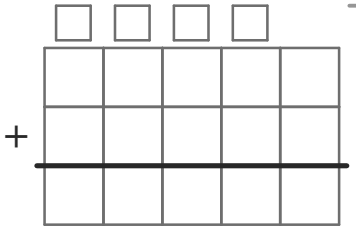

5 2385 ＋ 2789 ＝ ＿＿＿＿

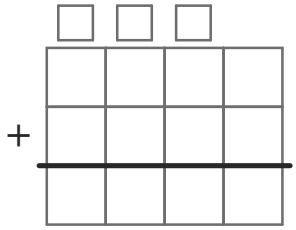

6 9465 ＋ 9732 ＝ ＿＿＿＿

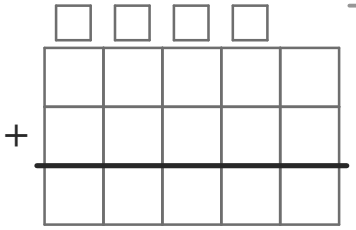

7 5352 ＋ 1877 ＝ ＿＿＿＿

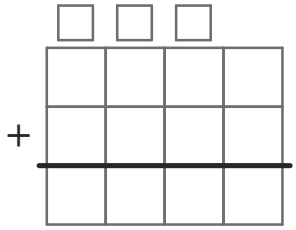

8 4474 ＋ 9911 ＝ ＿＿＿＿

