小3 たし算の筆算 とっくんドリル①-5

なまえ ＿＿＿＿＿＿＿＿

くり上がりを、わすれずに足す 全8問

ひづけ ＿＿＿＿＿＿＿＿

筆算のマスを使ってとく。くり上がりは、次のくらいの上の小さなマスに書く。答えは下線に書く

1 637 + 115 = ＿＿＿＿＿＿

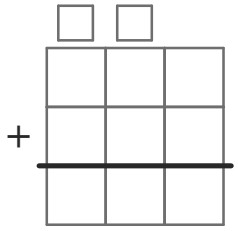

2 346 + 356 = ＿＿＿＿＿＿

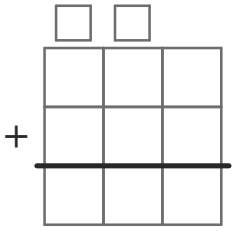

3 425 + 439 = ＿＿＿＿＿＿

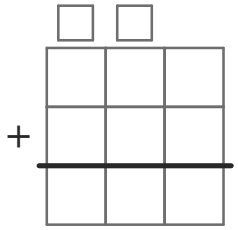

4 149 + 797 = ＿＿＿＿＿＿

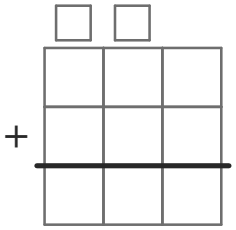

5 739 + 211 = ＿＿＿＿＿＿

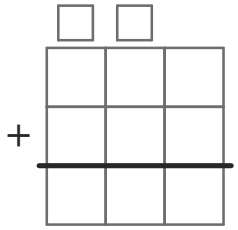

6 118 + 699 = ＿＿＿＿＿＿

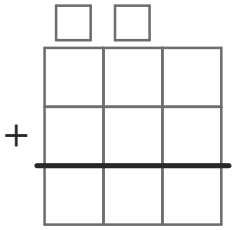

7 118 + 353 = ＿＿＿＿＿＿

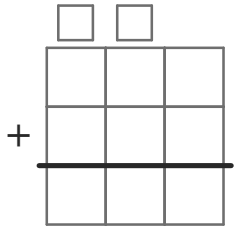

8 286 + 345 = ＿＿＿＿＿＿

