小3 たし算の筆算 とっくんドリル①-4

なまえ ＿＿＿＿＿＿＿＿

くり上がりを、わすれずに足す 全8問

ひづけ ＿＿＿＿＿＿＿＿

筆算のマスを使ってとく。くり上がりは、次のくらいの上の小さなマスに書く。答えは下線に書く

1 527 + 265 = ＿＿＿＿＿＿

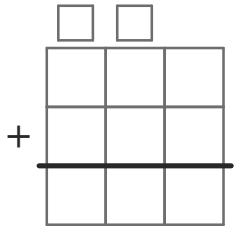

2 469 + 167 = ＿＿＿＿＿＿

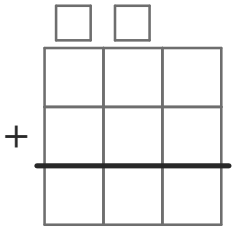

3 326 + 256 = ＿＿＿＿＿＿

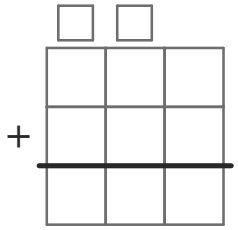

4 269 + 486 = ＿＿＿＿＿＿

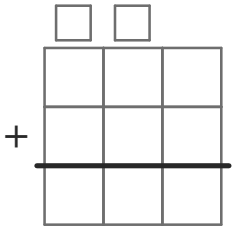

5 318 + 316 = ＿＿＿＿＿＿

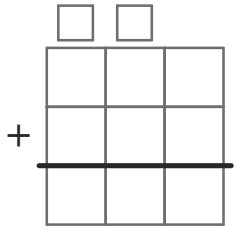

6 179 + 748 = ＿＿＿＿＿＿

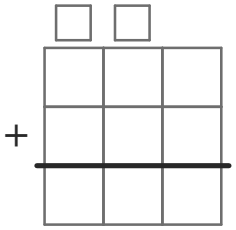

7 212 + 548 = ＿＿＿＿＿＿

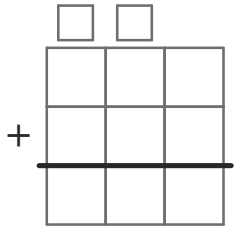

8 186 + 645 = ＿＿＿＿＿＿

