小3 たし算の筆算 とっくんドリル①-3

なまえ ＿＿＿＿＿＿＿＿

くり上がりを、わすれずに足す 全8問

ひづけ ＿＿＿＿＿＿＿＿

筆算のマスを使ってとく。くり上がりは、次のくらいの上の小さなマスに書く。答えは下線に書く

1 729 + 266 = ＿＿＿＿＿＿

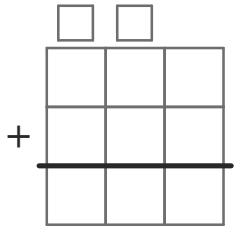

2 199 + 117 = ＿＿＿＿＿＿

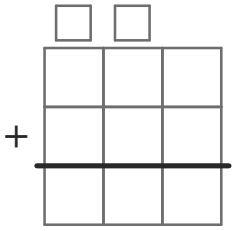

3 223 + 367 = ＿＿＿＿＿＿

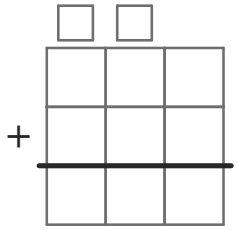

4 335 + 196 = ＿＿＿＿＿＿

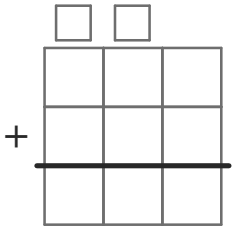

5 432 + 249 = ＿＿＿＿＿＿

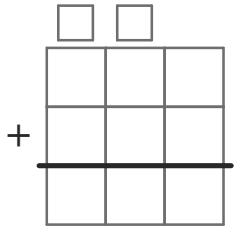

6 177 + 129 = ＿＿＿＿＿＿

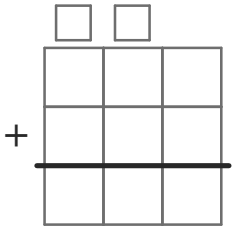

7 329 + 253 = ＿＿＿＿＿＿

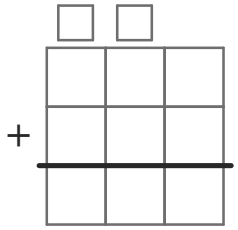

8 158 + 454 = ＿＿＿＿＿＿

