小3 たし算の筆算 とっくんドリル①-2

なまえ ＿＿＿＿＿＿＿＿

くり上がりを、わすれずに足す 全8問

ひづけ ＿＿＿＿＿＿＿＿

筆算のマスを使ってとく。くり上がりは、次のくらいの上の小さなマスに書く。答えは下線に書く

1 552 + 328 = ＿＿＿＿＿＿

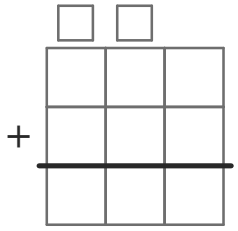

2 386 + 127 = ＿＿＿＿＿＿

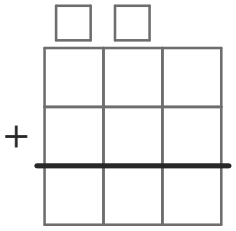

3 447 + 144 = ＿＿＿＿＿＿

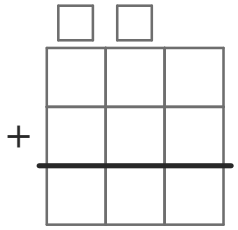

4 566 + 187 = ＿＿＿＿＿＿

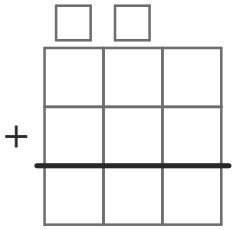

5 259 + 731 = ＿＿＿＿＿＿

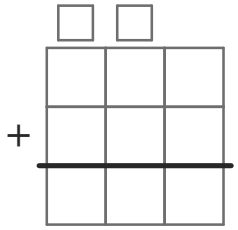

6 227 + 186 = ＿＿＿＿＿＿

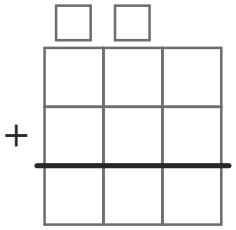

7 259 + 122 = ＿＿＿＿＿＿

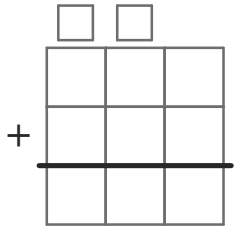

8 394 + 546 = ＿＿＿＿＿＿

