小3 たし算の筆算 とっくんドリル①-1

なまえ ＿＿＿＿＿＿＿＿

くり上がりを、わすれずに足す 全8問

ひづけ ＿＿＿＿＿＿＿＿

筆算のマスを使ってとく。くり上がりは、次のくらいの上の小さなマスに書く。答えは下線に書く

1 314 + 446 = ＿＿＿＿＿＿

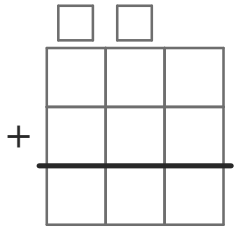

2 366 + 358 = ＿＿＿＿＿＿

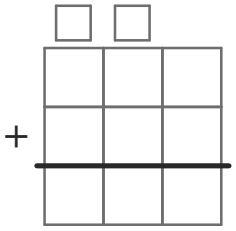

3 145 + 539 = ＿＿＿＿＿＿

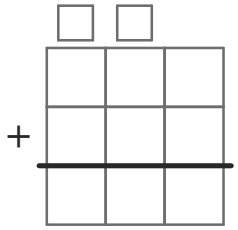

4 659 + 176 = ＿＿＿＿＿＿

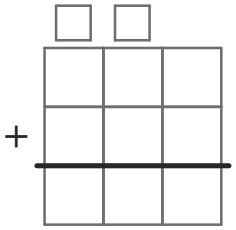

5 635 + 359 = ＿＿＿＿＿＿

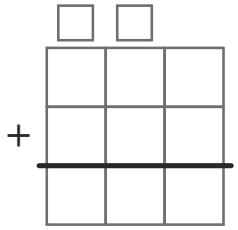

6 558 + 245 = ＿＿＿＿＿＿

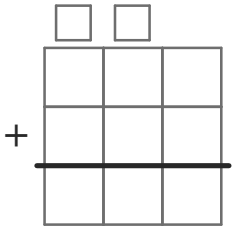

7 859 + 114 = ＿＿＿＿＿＿

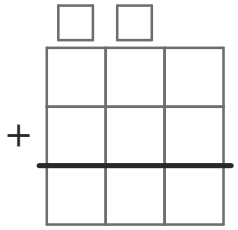

8 572 + 239 = ＿＿＿＿＿＿

